Expand:

a) (2a - 4)(3a - 5)

Factorise:

b) $x^2 - 9$

IN A COMPANY, THE RATIO OF THE NUMBER OF MEN TO THE NUMBER OF WOMEN IS 3 : 7

20% OF THE WOMEN ARE UNDER THE AGE OF 30
60% OF THE MEN ARE UNDER THE AGE OF 30

WHAT PERCENTAGE OF PEOPLE IN THE COMPANY ARE UNDER THE AGE OF 30?

Write the number of right handed boys to girls as a fraction in its simplest form.

	Boys	Girls
Left	11	29
Right	21	28

Four numbers have a median of 6, a mean of 6 and a range of 7. The numbers are not integers. What could they be?

AB, CDE and FG are parallel. Work out the size of angle *x*.

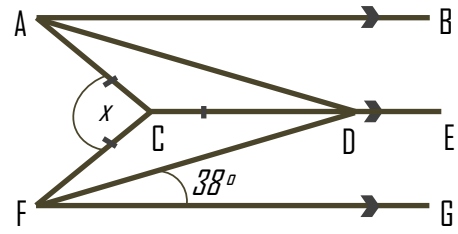

ABE and CBD are straight lines. Prove that ABC in an isosceles triangle.

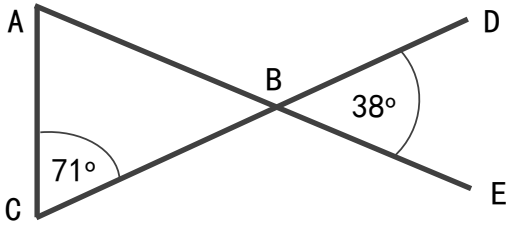

Three straight lines are shown. Work out the value of x

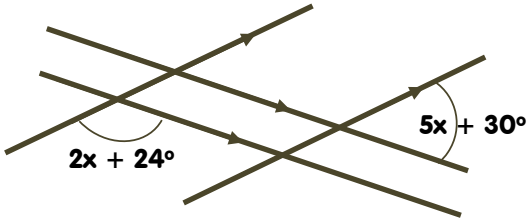

There's orange, yellow and blue sweets in a box. The ratio of the sweets in the box is 7 : 3 : 5

What percentage of the sweets are yellow?

Teacher Feedback

WWW:

Target:

Date:

R A G